LESSON 7•8

Written Assessment *continued*

6. How many letters do the greatest number of children have in their names? _____

How many letters do the fewest number of children have in their names? _____

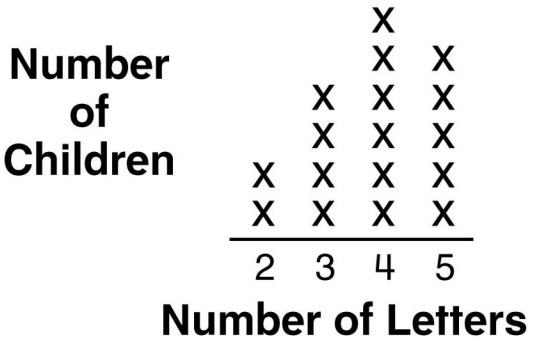

Part B

7. Complete the table.
Fill in the missing rule.

in	out
4	8
	11
13	
20	24

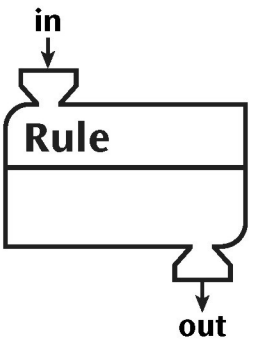

8. Draw the hands.



11:15

9. Show 68¢ in two ways. Use Ⓠ, Ⓓ, Ⓝ, and Ⓟ.

Copyright © Wright Group/McGraw-Hill